www.sgexam.com

Founded 1947

# 南侨小学

# NAN CHIAU PRIMARY SCHOOL

## MATHEMATICS

## PRIMARY 2

## LEARNING REVIEW

Name: _____ _____( )

Class: Pr 2 _____ Duration: 40 minutes

Parent's Signature: _____

---

Instructions to Students:

1. Do NOT open this booklet until you are told to do so.
2. Follow all instructions carefully.
3. Answer all questions.

*This paper consists of **6** pages altogether.

www.sgexam.com

www.sgexam.com

www.sgexam.com

www.sgexam.com

**Section A**

Questions 1 to 12 carry 2 marks each. For each question, show your working and write the correct answer in the box provided. (24 marks)

1. How many ☐ are there?

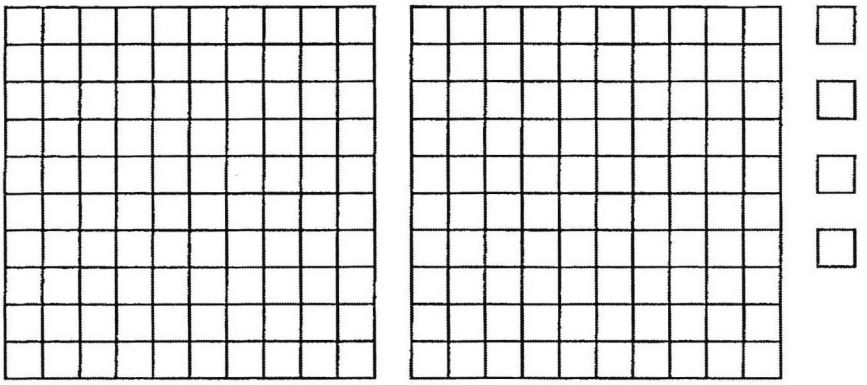

2. In 926, the digit _____ is in the hundreds place.

3. Write three hundred and eight in numerals.



www.sgexam.com

www.sgexam.com

4. Arrange the numbers from the greatest to the smallest.

714 , 147 , 174 , 417

[ ] , [ ] , [ ] , [ ]

greatest

---

5. Find 428 – 307.

$$\begin{array}{r} 4\ 2\ 8 \\ -\ 3\ 0\ 7 \\ \hline \\ \hline \end{array}$$

[ ]

---

6. 725 + 9 = _____

[ ]

---

7. Add 28 and 694.

[ ]

---



www.sgexam.com

www.sgexam.com

8. Subtract 23 from 600.

9. What is the missing number in the box?

$$\begin{array}{rccc} & 9 & 1 & \boxed{?} \\ - & 3 & 4 & 3 \\ \hline & 5 & 6 & 9 \\ \hline \end{array}$$

10. Lisa thinks of a 3-digit odd number.
The digit 4 is in the hundreds place.
The value of the digit 1 is 10.
The digit in the ones place is more than 5 but less than 8.
What is the number?



www.sgexam.com

www.sgexam.com

11. James had 8 stamps at first.
His brother gave him 4 stamps.
His mother bought him another 5 stamps.
How many stamps did James have altogether?



---

12. Sally and Don have 200 seashells. Sally has 80 seashells.

Which of the following statement(s) is/are correct?
Tick (✓) the **box(es)** that is/ are correct.

 Don has 280 seashells.

 Don has 120 seashells.

 Sally has more seashells than Don.

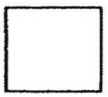 Sally has fewer seashells than Don.

---



www.sgexam.com

www.sgexam.com

**Section B**

Questions 13 to 15 carry 2 marks each. Work out the word problems carefully. Show your working and equations clearly in the spaces provided.

(6 marks)

---

13. James has 530 stickers. William has 160 stickers.
How many stickers do they have altogether?

They have _____ stickers altogether.

---

14. Yassin bakes 277 cookies. Kim bakes 430 cookies.
How many more cookies does Kim bake than Yassin?

Kim bakes _____ more cookies than Yassin.

---



www.sgexam.com

www.sgexam.com

15. A florist had 503 stalks of roses.
After selling some stalks of roses, she had 95 stalks of roses left.
How many stalks of roses did she sell?

She sold _____ stalks of roses.

---

- End of paper -



www.sgexam.com

www.sgexam.com

SCHOOL : NAN CHIAU PRIMARY SCHOOL

LEVEL : PRIMARY 2
SUBJECT : MATH

---

1) 200 + 4 = 204
2) 9
3) 308
4) 714 , 417 , 174 , 147
5) 121
6) 734
7) 722
8) 577
9) 2
10) 417
11) 8 + 4 + 5 = 17
12) Don has 120 seashells. / Sally has fewer seashells than Don.
13) 530 + 160 = 690
14) 430 + 277 = 153
15) 503 – 95 = 408



www.sgexam.com